Summer Math Homework

· due on first week of school

Name: _____

Addition

Find the sums.

a. 72 + 19 = ____

b. 46 + 27 = ____

c. 14 + 33 = ____

d. 83 + 36 = ____

e. 50 + 57 = ____

f. 67 + 8 = ____

g. 56 + 65 = ____

h. 44 + 46 = ____

i. 5 + 29 = ____

j. 38 + 27 = ____

k. 99 + 99 = ____

l. Sam has 29 books.
Jan has 44 books.
How many books do they have altogether? _____

m. Nate has 47 chapter books.
He buys 13 more.
How many chapter books does he have in all? _____

Name: _____

Addition

Find the sums.

a. 357 + 208

b. 299 + 234

c. 483 + 95

d. 250 + 590

e. 774 + 526

f. 878 + 316

g. 687 + 678

h. 160 + 74

i. $816 + $905

j. $999 + $777

k. Mr. Sanford bought a new grill and picnic table for his backyard. He spent $178 on the grill and $467 on the picnic table. How much did he spend in all?

_____

k. Mr. Sanford had a huge outdoor party. He grilled 145 hamburgers and 247 cheeseburgers for his guests. How many burgers did he grill in all?

_____

Name: _____

Telling Time

Write the time shown.

a.



_____

b.



_____

c.



_____

d.



_____

e.



_____

f.

_____

g.

_____

h.

_____

i.



_____

Name: _____ Time to the Nearest Minute

Telling Time

To the Nearest Minute

Write the time shown on each clock.

a.

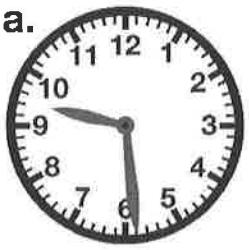

____ : ____

b.

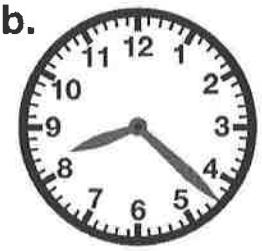

____ : ____

c.

____ : ____

d.



____ : ____

e.



____ : ____

f.

____ : ____

g.

____ : ____

h.

____ : ____

i.

____ : ____

Name: _____

Rounding to the Nearest Ten

Round each number to the nearest ten.

a.	34	_____	**b.**	87	_____
c.	7	_____	**d.**	15	_____
e.	65	_____	**f.**	32	_____
g.	26	_____	**h.**	91	_____
i.	99	_____	**j.**	56	_____
k.	23	_____	**l.**	17	_____
m.	3	_____	**n.**	40	_____
o.	75	_____	**p.**	86	_____
q.	549	_____	**r.**	351	_____
s.	788	_____	**t.**	655	_____
u.	920	_____	**v.**	416	_____

Write all of the numbers that round to 50.

_____, _____, _____, _____, _____, 50, _____, _____, _____, _____

Write all of the numbers that round to 80.

_____, _____, _____, _____, _____, 80, _____, _____, _____, _____

Write all of the numbers that round to 240.

_____, _____, _____, _____, _____, 240, _____, _____, _____, _____

Name: _____

Rounding to the Nearest Hundred

Round each number to the nearest hundred.

a. 465 _____

b. 945 _____

c. 902 _____

d. 123 _____

e. 834 _____

f. 391 _____

g. 498 _____

h. 854 _____

i. 69 _____

j. 268 _____

k. 110 _____

l. 893 _____

m. 345 _____

n. 688 _____

o. 238 _____

p. 835 _____

q. 469 _____

r. 384 _____

s. 575 _____

t. 629 _____

u. Craig is an auto mechanic. He has 51 lug nuts in a bucket. Round this number to the nearest hundred. _____

v. Craig repaired 348 cars this year. Round this number to the nearest hundred. _____

Name _____

Up the Waterspout

It's a race! Each spider has one minute to climb up the waterspout.
Use the race results to complete the bar graph.
Then answer the questions.

Race Results

Itsy	10 inches
Bitsy	15 inches
Teeny	6 inches
Tiny	17 inches
Inky	20 inches
Dinky	3 inches

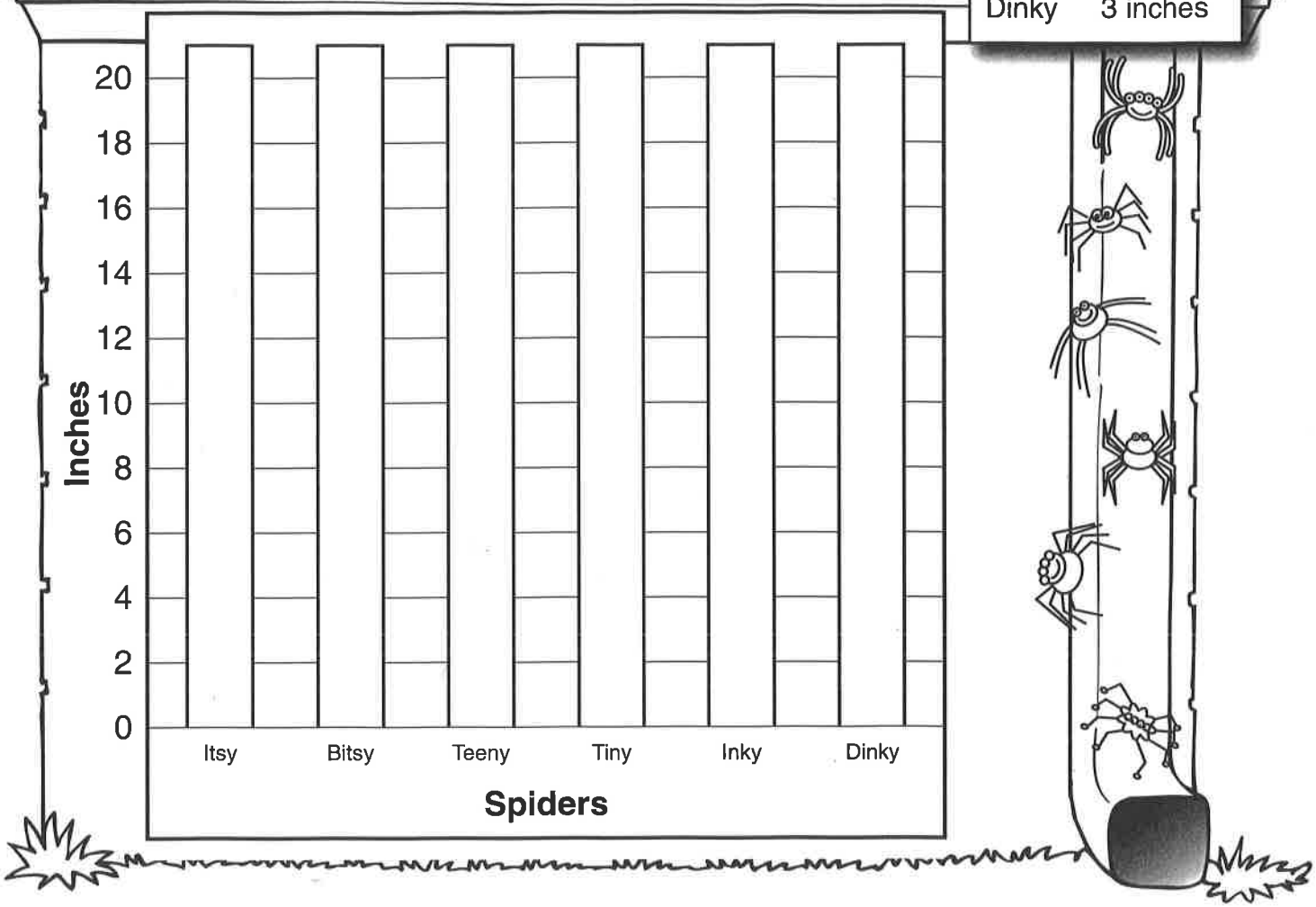

1. Which spider climbed the highest distance? _____
2. Which spider climbed the shortest distance? _____
3. Which spider climbed higher than Dinky but not as high as Itsy? _____
4. Which spider climbed higher than Bitsy but not as high as Inky? _____
5. Which spider climbed higher than Teeny but not as high as Bitsy? _____
6. How much higher did Tiny climb than Itsy? _____
7. How much higher did Bitsy climb than Dinky? _____
8. How much higher did Inky climb than Teeny? _____

Bonus Box: How many inches did the spiders climb in all?

©The Education Center, Inc. • *Teacher's Helper*® • TEC47009 • Oct/Nov 2003

Name: _____

African Safari Adventure

Math Story by Claudette J. Young

Kit and Matthew began their African safari at the watering hole. They had two days to see all the wildlife they could. Their parents and the guide kept them safe.



The first morning ten elephants claimed the waterhole for their morning bath. Soon Kit counted eighteen zebras coming for water. A dozen baboons wandered in and started making noise and acting silly. Matthew laughed hard and loud at their antics. His noise sent five zebras running off.



The next day everyone rode into the bush. They paused to look at a lone rhino standing in a clearing. While they were looking, the rhino began to charge them. Kit and Matthew screamed, but the guide drove them to safety. Further on they found a pride of eight lions dozing under an acacia tree. Above the lions played twenty-two monkeys in the tree.

Matthew and Kit saw a giraffe with a baby standing beside a tree. The giraffe stretched to reach its food with its tongue. A trio of jackals moved nearby to threaten them. The jackals ran out of sight when the jeep came too close to them.

Everyone was tired. They'd seen no leopards, or hyenas, or cheetahs. Lions hadn't roared, but a rhino had threatened them. What an exciting adventure they had!

Name: _____

African Safari Bar Graph

Number of animals seen:

elephants - _____ zebras - _____ baboons - _____

rhinos - _____ lions - _____ monkeys - _____

giraffes - _____ jackals - _____

graph title: _____

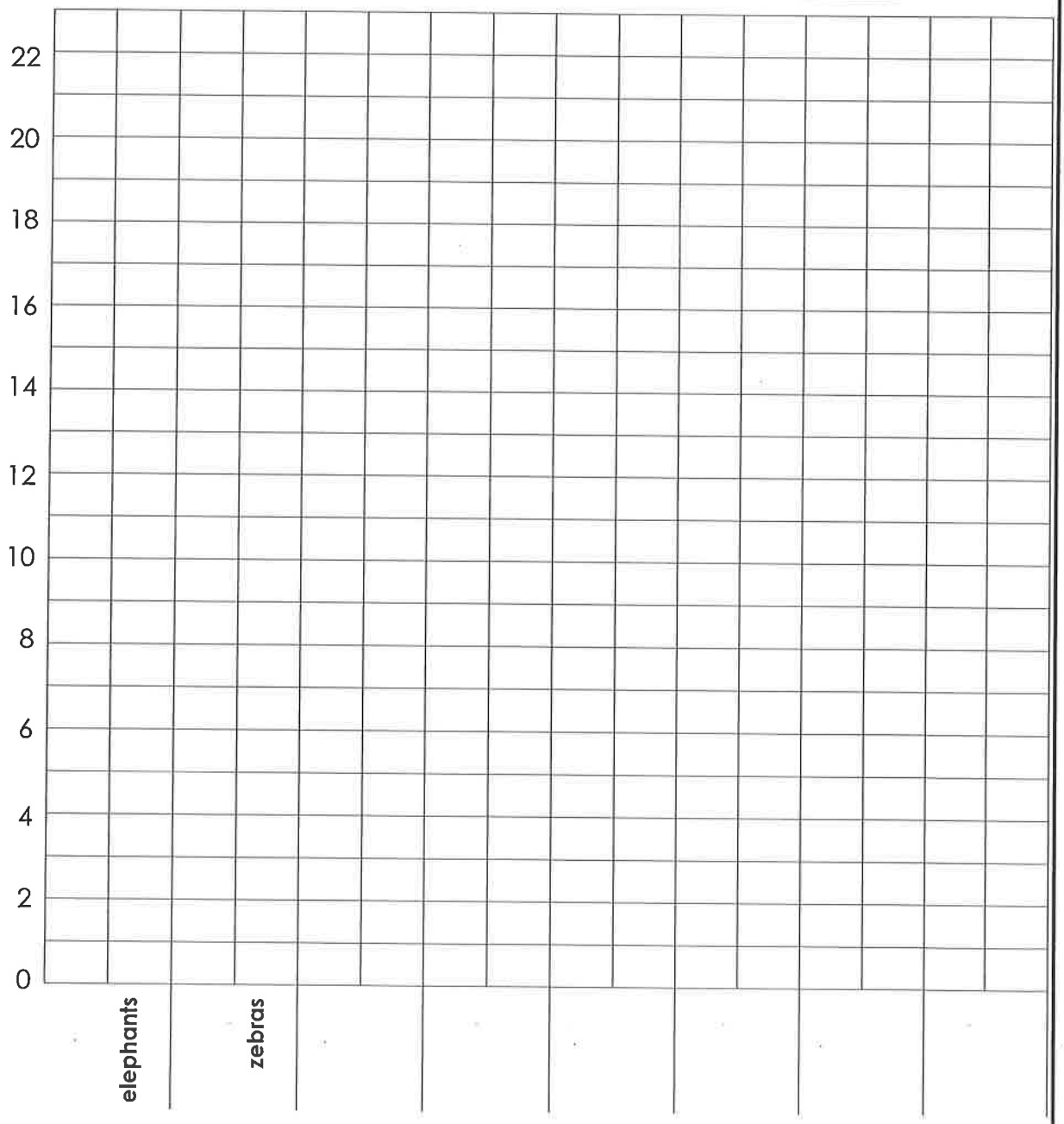

Name: _____

African Safari Adventure

Math Story by Claudette J. Young

Use information from the story to answer the questions.
Show your work in the space to the right.



1. How many animals did the children see their first day on safari?

answer: _____

2. How many zebras were left at the waterhole when some of them were startled by Matthew's laughter?

answer: _____

3. If seven monkeys fell out of the acacia tree and ran off, how many would be left in the branches?

answer: _____

4. How many jackals were left when the jeep came too close?

answer: _____

5. If the pride of lions went to the waterhole that first day, how many animals would have been there?

answer: _____